LernPunkt Nachhilfeinstitut M.Mechora-Krüger & M. Krüger GbR

Einfache Trigonometrie - TRIG - TEST

Name_____ Datum____

Bestimme die Werte!

1) sin 52°

2) sin 63°

3) sin Z

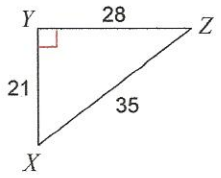

4) tan A

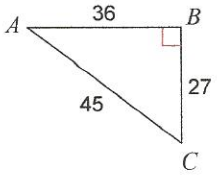

Bestimme die fehlenden Winkel!

5)

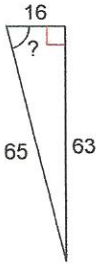

6)

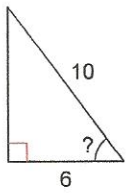

7)

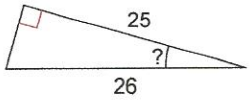

8)

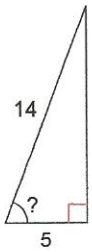

Bestimme die fehlenden Seiten!

9)

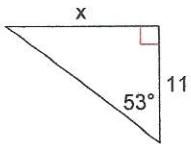

10)

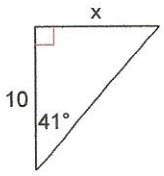

11)

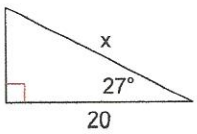
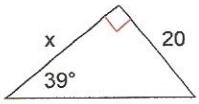
12)