LernPunkt Nachhilfeinstitut M.Mechora-Krüger & M. Krüger GbR

Einfache Trigonometrie - TRIG 3 (Seiten bestimmen)

Name_____ Datum____

Bestimme die fehlende Seite!

1)

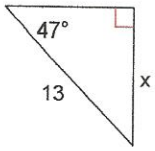

2)

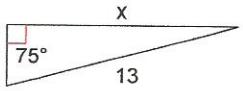

3)

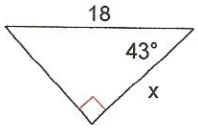

4)

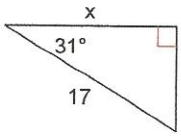

5)

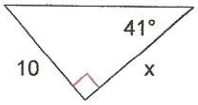

6)

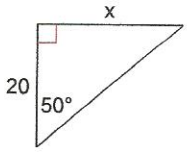

7)

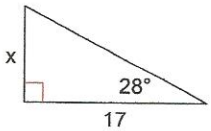

8)

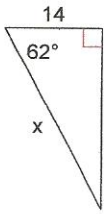

9)

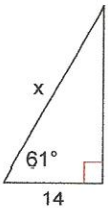

10)

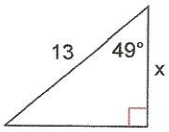

11)

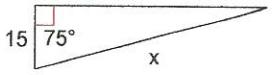

12)

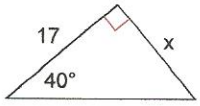

13)

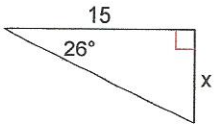
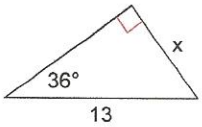
14)